What Were the Headlines After a Mad Scientist Trained Two Eggs to Attack a Candy Store With Sharp Sticks ?

Solve each system of equations below by graphing. Cross out the box containing your answer. When you finish, print the letters from the remaining boxes in the spaces at the bottom of the page.



(1) $y = \frac{2}{3}x - 1$
$y = -x + 4$

(2) $y = -2x + 1$
$y = x - 5$

(3) $y = \frac{1}{2}x - 3$
$y = \frac{3}{2}x - 1$

(4) $y = 2x$
$x + y = 3$

(5) $x + y = 0$
$3x + y = -4$

(6) $x = 3 - 3y$
$x + 3y = -6$

(7) $x + 2y = -4$
$4y = 3x + 12$

(8) $y = -2$
$2x - 5y = 20$

(9) $4x + 3y = -15$
$y = x + 2$

TW (−4, 0)	EG (−4, −5)	OS no solution	GS (4, 1)	WE (3, 1)	ET (−2, −4)	SP (−1, 6)	TR (−3, −1)
EA (−3, 5)	TS (1, 2)	RA (0, 3)	TI (2, −3)	MI (4, −3)	SS (5, −2)	NT (−1, 0)	UP (−2, 2)

MPM1DI- *Unit 6B: Graphing Relations- Lesson 7–Worksheet #7* Date: _____

1

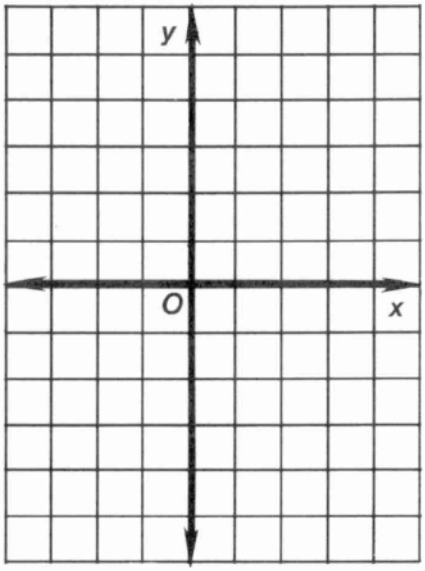

2

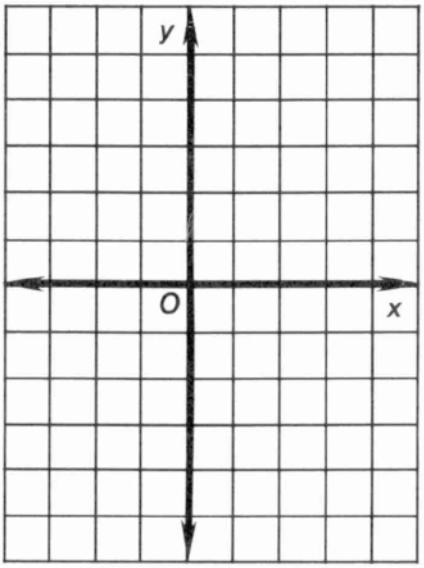

3

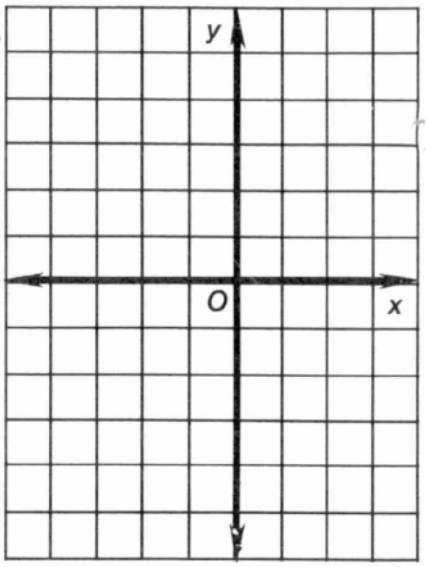

4

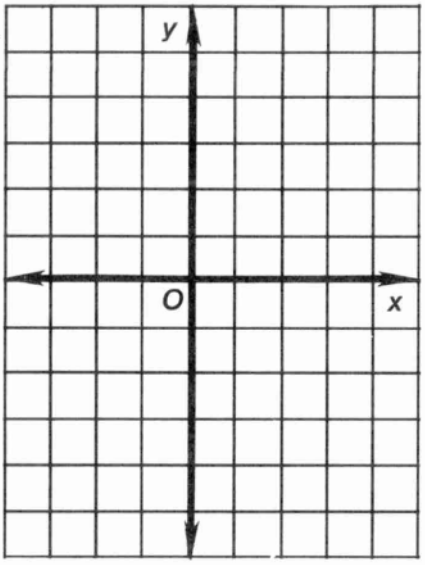

5

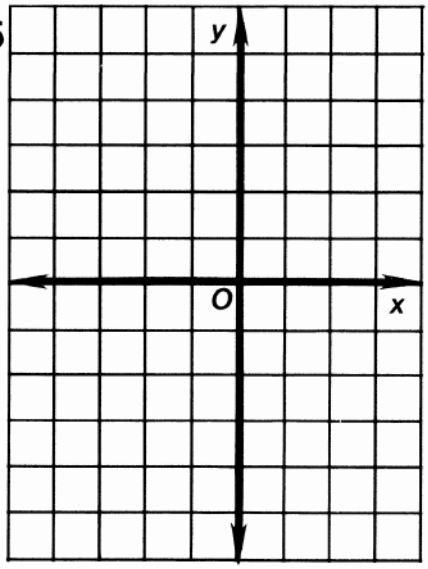

6

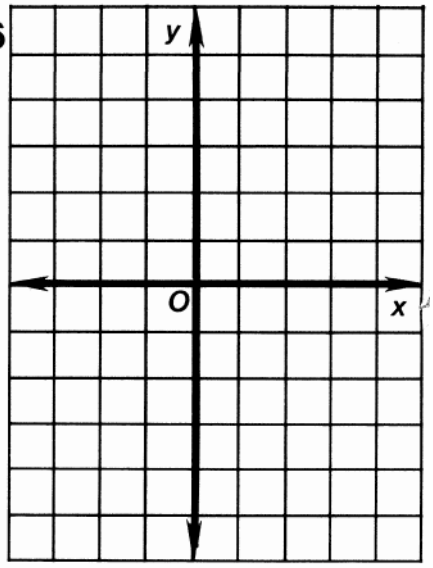

7

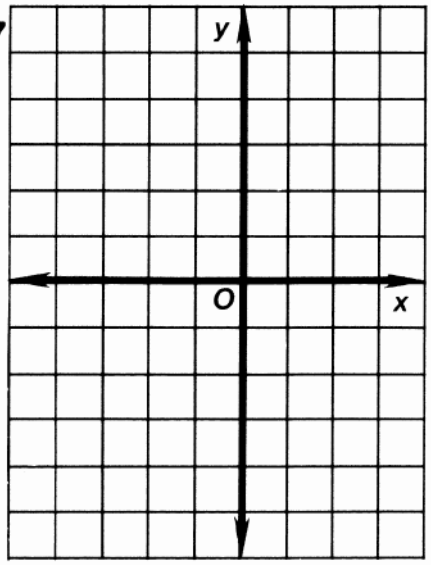

8

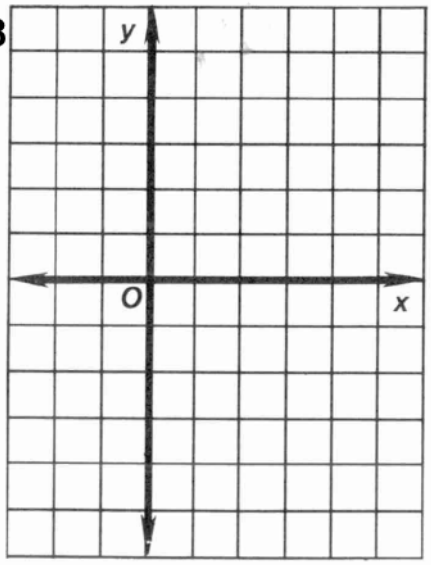
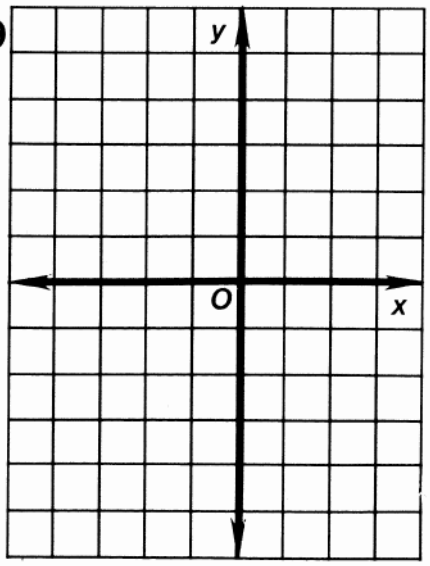
9